Name_____Class _____

Adding and Subtracting Practice + Models Review

Solve each problem below by using the chip model:

1. -9 + 5 =

2. -2 + -7 =

3. -9 - (-4) =

4. -5 - 2 =

Solve each problem below using the number line model:

5. -5 + 8 = _____

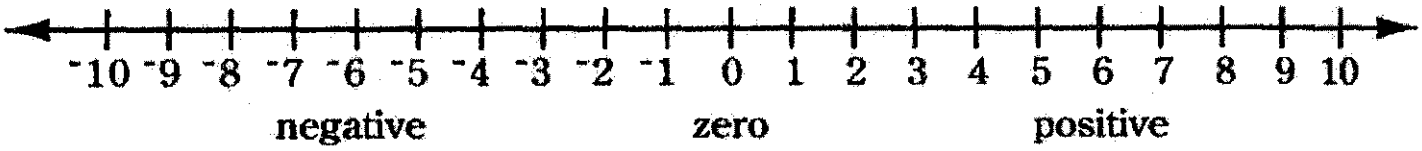

6. -7 + -2 = _____

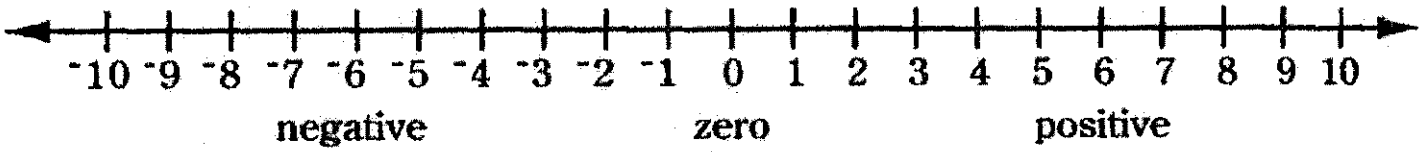

7. What addition sentence is modeled by the number line below? _____

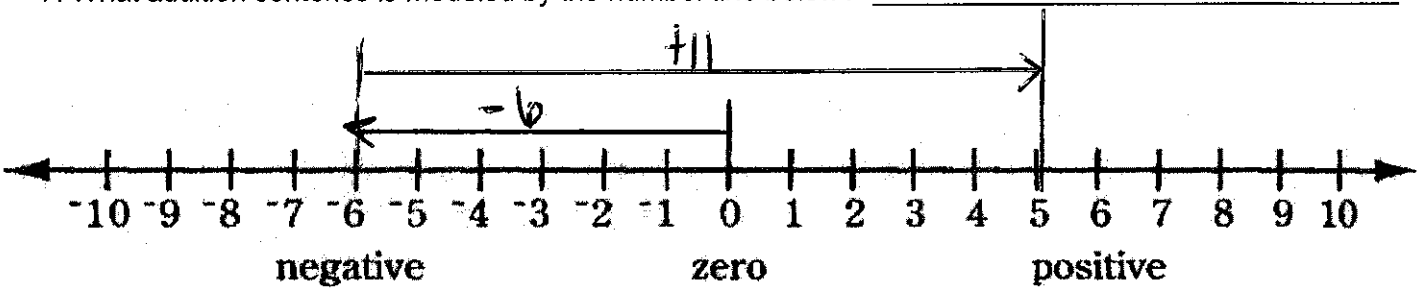

Solve the problems below using the hot air balloon model. Answer the questions and draw the vertical number line:



8. -3 - 5 =

Where does the balloon start? _____

Do you add or subtract something from the balloon? _____

What do you add or subtract from the balloon? _____

Does the balloon move up or down? _____

Where does the balloon end up? _____

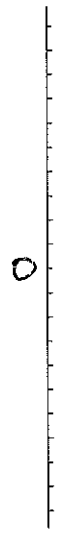

9. 6 + -4

Where does the balloon start? _____

Do you add or subtract something from the balloon? _____

What do you add or subtract from the balloon? _____

Does the balloon move up or down? _____

Where does the balloon end up? _____

#10-27:

-4 + 8 =	9 - 5 =	-14 + 4 =	-39 + -3 =	-9 - 4 =	9 - 12 =
84 + -5 =	-95 + -7 =	-8 - (-4) =	-12 - (-26) =	-65 + 65 =	-42 - 5 =
-4 + -4 =	-3 - 12 =	-5 - (-5) =	45 - (-2) =	-36 + -15 =	0 - 7 =